COLÉGIO ACADEMOS
FUNDAMENTAL I



ALUNO: _____

SÉRIE: 1º TURNO: Manhã / Tarde DATA: 27 / 03 / 2020

PROFESSORA: _____ DISCIPLINA: Matemática

1 – Conte e registre na tabela a quantidade de elementos da páscoa.



2 – Agora pinte o gráfico de acordo com as quantidades encontradas.